Put Landsat on the Map!

A – River delta



B – High mountains

C – Canola farm fields

D – Sprawling city

E – Algal bloom



F – Desert dunes



G – Wildfire



H – Glacier & icebergs



Match the letter of the Landsat images above with the location on the map!

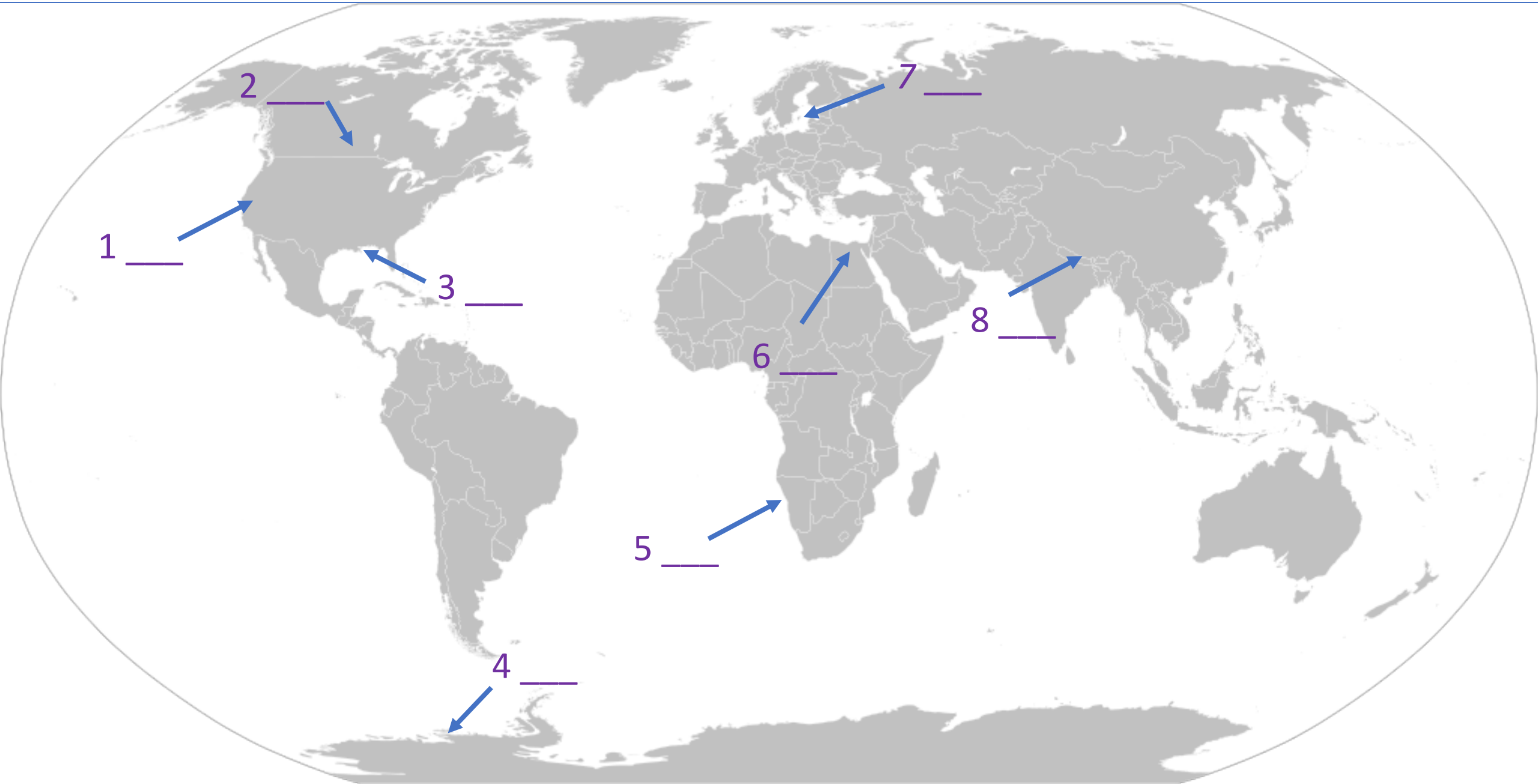

Answer Key!
(Click the links to learn more)

#1 = G: Wildfire near Paradise, California (https://landsat.visibleearth.nasa.gov/view.php?id=144225)

#2 = C: Farm fields in Canada (https://landsat.visibleearth.nasa.gov/view.php?id=145517)

#3 = A: Mississippi River Delta (https://landsat.visibleearth.nasa.gov/view.php?id=85519)

#4 = H: Antarctic Icebergs (https://landsat.visibleearth.nasa.gov/view.php?id=144212)

#5 = F: Namibian sand dunes (https://landsat.visibleearth.nasa.gov/view.php?id=92695)

#6 = D: Cairo and the Nile (https://landsat.visibleearth.nasa.gov/view.php?id=146521)

#7 = E: Algal bloom in the Baltic Sea (https://landsat.visibleearth.nasa.gov/view.php?id=92462)

#8 = B: Himalaya & Mt Everest (https://landsat.visibleearth.nasa.gov/view.php?id=81597)

Investigate more at landsat.gsfc.nasa.gov